DOWNLOAD

Petra Schön/Andrea Pogoda Saam

Plus- und Minus-aufgaben im Zahlenraum bis 20

VORSCHAU

Downloadauszug aus dem Originaltitel:

netzwerk lernen

zur Vollversion

Wir rechnen über den Zehner

- Lege, male und rechne!

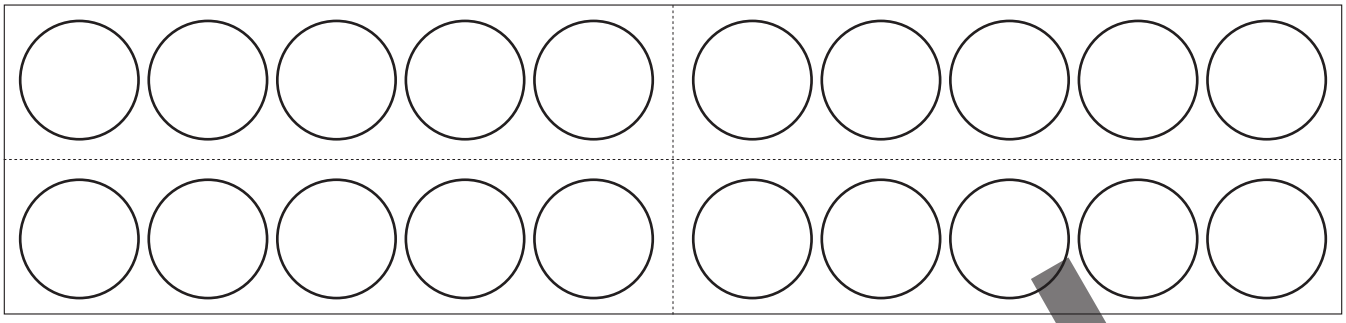

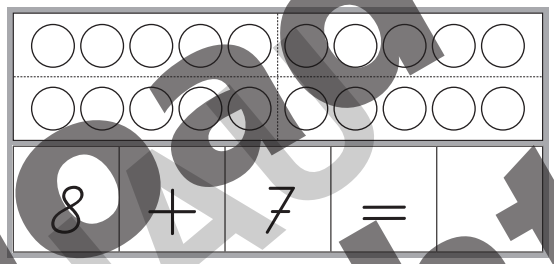

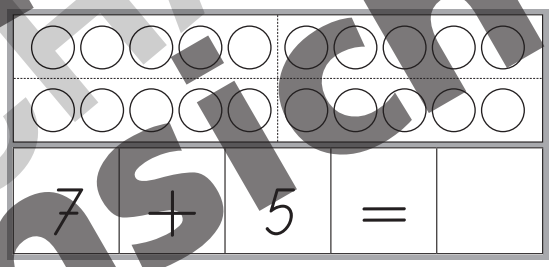

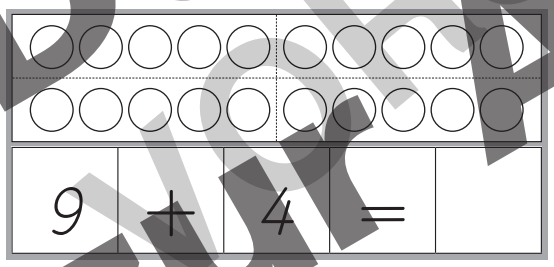

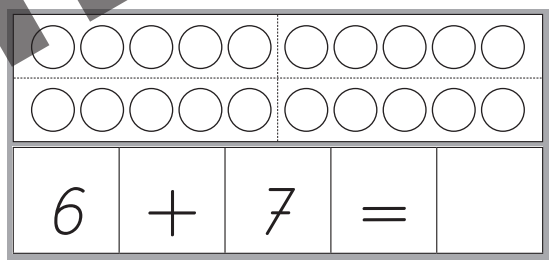

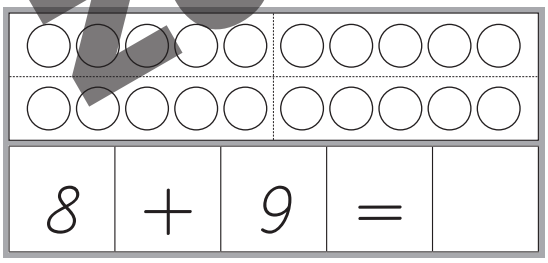

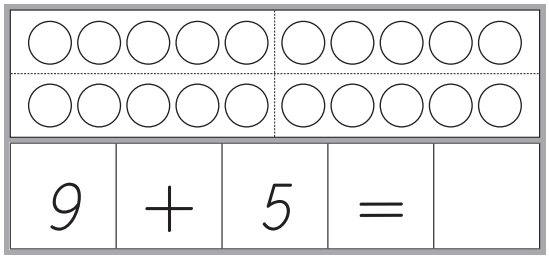

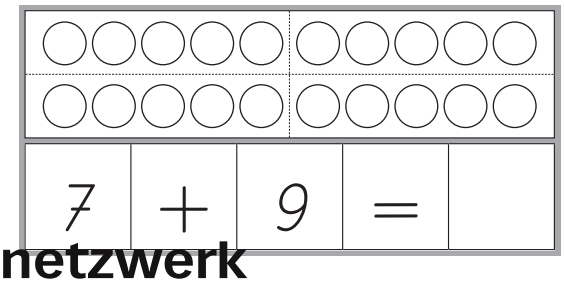

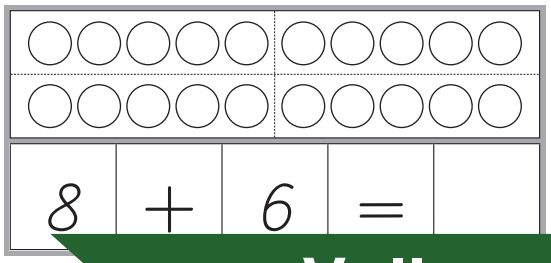

Download zur Ansicht
VORSCHAU
netzwerk lernen
zur Vollversion

© Persen Verlag GmbH, Buxtehude

Wir rechnen über den Zehner

① Male und rechne!

9	+	2	=	
7	+	6	=	
8	+	6	=	
7	+	4	=	

8	+	4	=	
6	+	8	=	
5	+	7	=	
6	+	5	=	

② Finde eigene Plusaufgaben über den Zehner! Male und rechne!

	+		=	

	+		=	

	+		=	

	+		=	

Download zur Ansicht

netzwerk lernen
zur Vollversion

© Persen Verlag GmbH, Buxtehude

Wir rechnen über den Zehner

- Finde eigene Plusaufgaben! Lege, male und rechne!

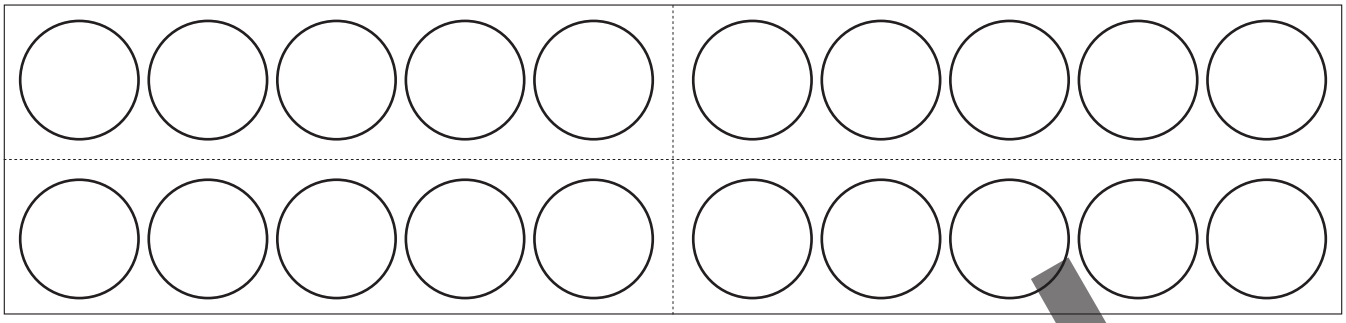

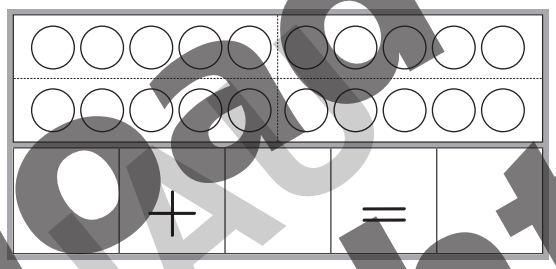

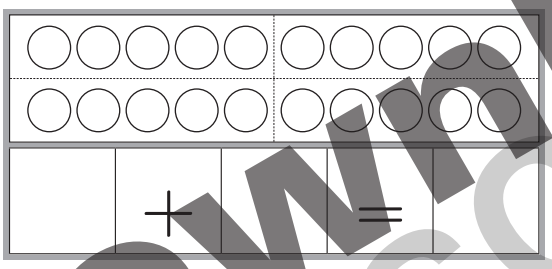

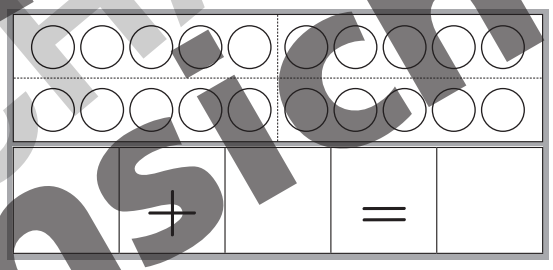

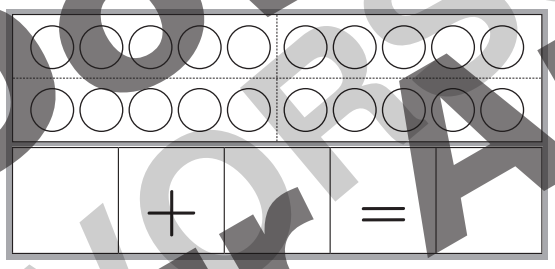

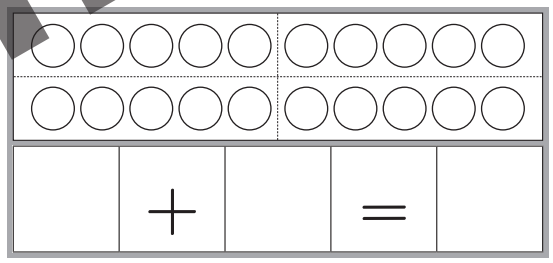

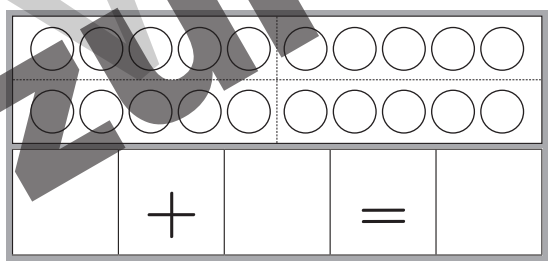

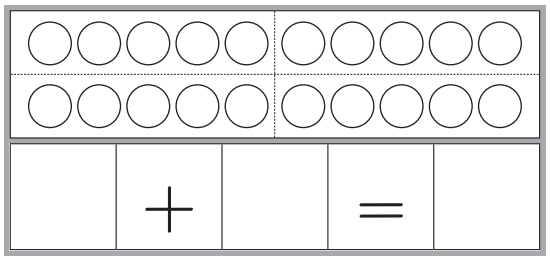

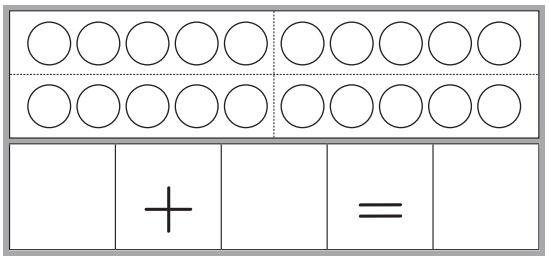

Download zur Ansicht
VORSCHAU

© Persen Verlag GmbH, Buxtehude
netzwerk lernen
zur Vollversion

Name: Datum:

Wir rechnen über den Zehner

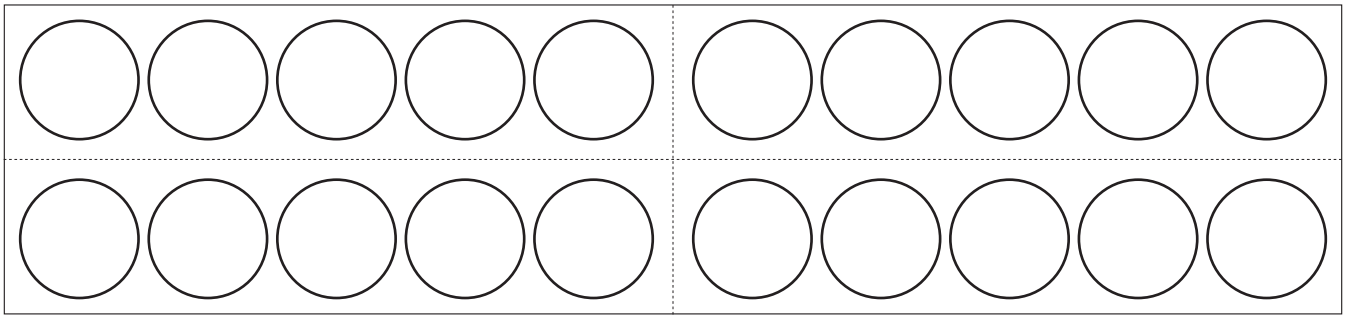

① Lege, male und rechne!

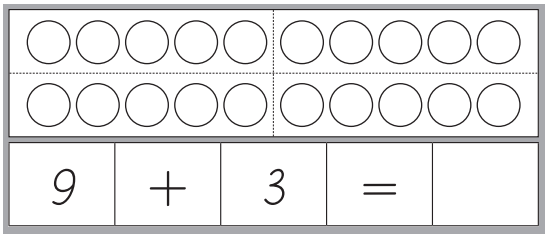

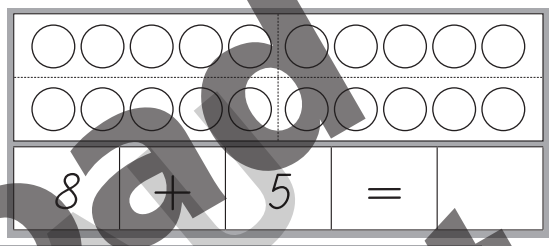





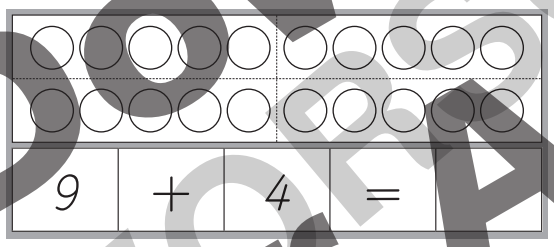

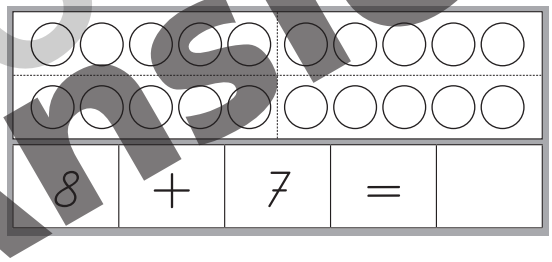

② Entscheide, ob es Aufgaben über den Zehner sind! Lege und kreuze an!

6 + 7	○	3 + 6	○
5 + 4	○	5 + 9	○
6 + 4	○	8 + 8	○

③ Finde eigene Plusaufgaben über den Zehner!

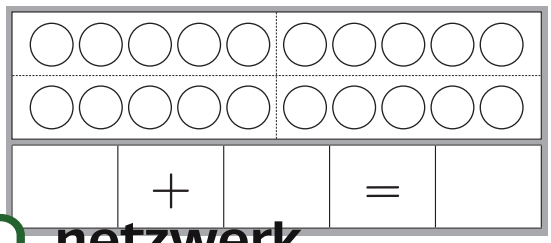

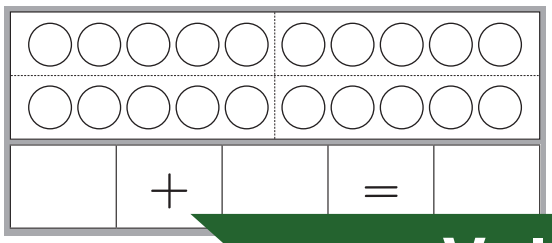

Download zur Ansicht

netzwerk lernen

zur Vollversion

© Persen Verlag GmbH, Buxtehude

Name: Datum:

Wir rechnen über den Zehner

① Rechne!

9	+	3	=	
9	+	6	=	
9	+	4	=	
9	+	7	=	
8	+	4	=	

8	+	6	=	
8	+	3	=	
8	+	7	=	

② Entscheide, ob es Aufgaben über den Zehner sind! Kreuze an!

6	+	7	◯
5	+	4	◯
8	+	3	◯

6	+	4	◯
3	+	6	◯
5	+	9	◯

7	+	4	◯
8	+	8	◯

③ Finde eigene Plusaufgaben über den Zehner!

	+		=	
	+		=	
	+		=	

	+		=	
	+		=	
	+		=	

Download zur Ansicht
VORSCHAU
netzwerk lernen
zur Vollversion

© Persen Verlag GmbH, Buxtehude

Name: Datum:

Wir rechnen über den Zehner

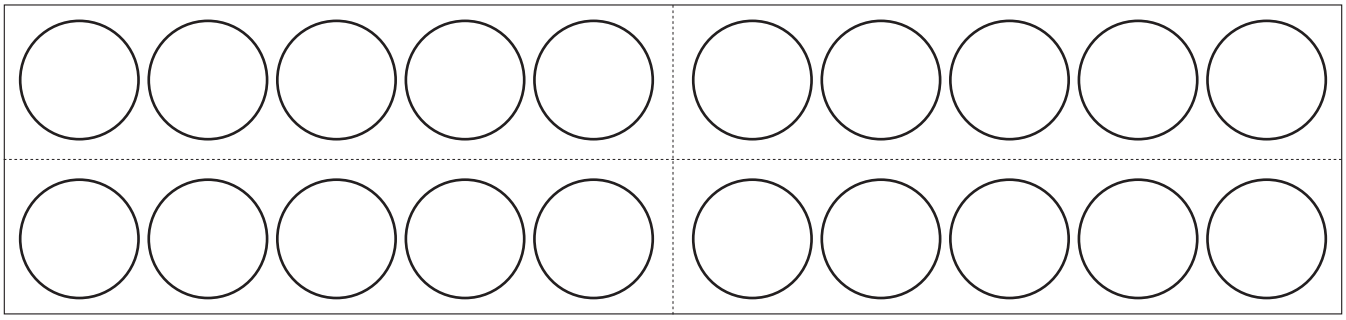

① Lege und rechne!

9	+	4	=	
6	+	8	=	
3	+	9	=	
7	+	4	=	
6	+	7	=	

8	+	5	=	
7	+	8	=	
5	+	9	=	
6	+	5	=	
7	+	9	=	

② Wie geht die Aufgabenreihe weiter? Lege und rechne!

5	+	5	=	
5	+	6	=	
5	+		=	
	+		=	
	+		=	

6	+	4	=	
7	+	4	=	
8	+		=	
	+		=	
	+		=	



③ Finde eigene Plusaufgaben über den Zehner!

	+		=	
	+		=	

	+		=	
	+		=	

Download VORSCHAU zur Ansicht

netzwerk lernen
zur Vollversion

© Persen Verlag GmbH, Buxtehude

Name: Datum:

Wir rechnen bis 20

① Schreibe die Plusaufgabe auf und rechne!

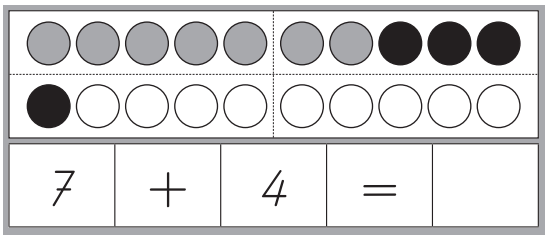

7	+	4	=	

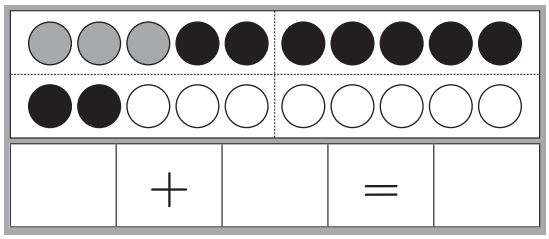

	+		=	

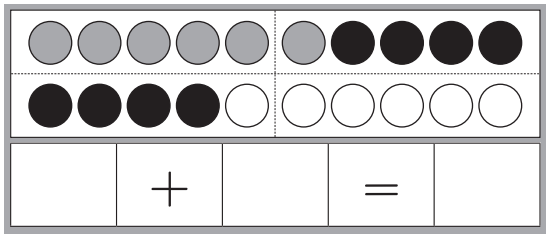

	+		=	



	+		=	

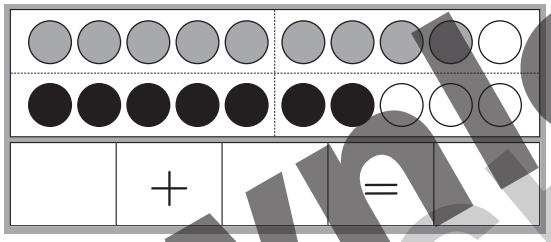

	+		=	

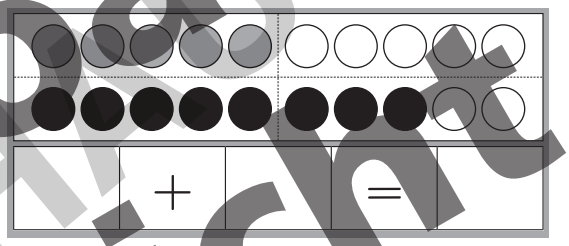

	+		=	

② Setze die Aufgabenreihe fort!

5	+	6	=	11
6	+	7	=	
7	+	8	=	
	+		=	
	+		=	

4	+	7	=	
5	+	7	=	
6	+	7	=	
	+		=	
	+		=	



③ Rechne! Was fällt dir auf?

6	+	4	=	
5	+	5	=	
4	+	6	=	
3	+	7	=	
2	+	8	=	

8	+	7	=	
10	+	5	=	
12	+	3	=	
13	+	2	=	
14	+	1	=	

13	+	4	=	
16	+	1	=	
10	+	7	=	
12	+	5	=	
8	+	9	=	

Download zur Ansicht VORSCHAU
netzwerk lernen
zur Vollversion

© Persen Verlag GmbH, Buxtehude

Name: Datum:

Wir rechnen über den Zehner

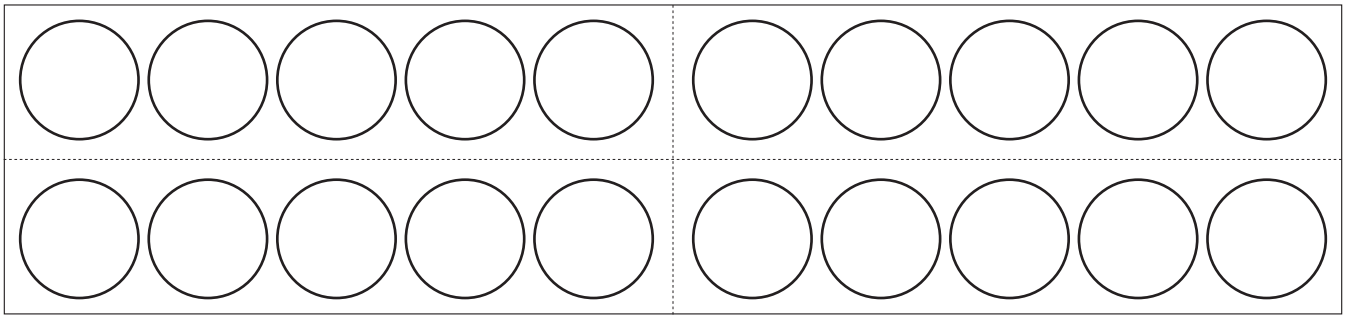

① Lege und rechne!

16	–	7	=	
12	–	5	=	
11	–	4	=	
13	–	5	=	
17	–	9	=	
14	–	7	=	
16	–	8	=	

13	–	8	=	
16	–	9	=	
14	–	6	=	
12	–	8	=	
15	–	7	=	

② Finde eigene Minusaufgaben über den Zehner! Lege und rechne!

	–		=	
	–		=	

	–		=	
	–		=	

Download VORSCHAU zur Ansicht

netzwerk lernen
zur Vollversion

© Persen Verlag GmbH, Buxtehude

Wir rechnen über den Zehner

① Schreibe die Aufgabe auf und rechne!

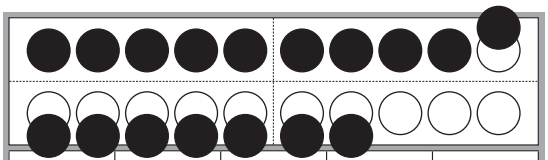

17	–	8	=	

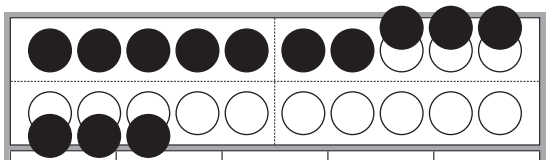

	–		=	

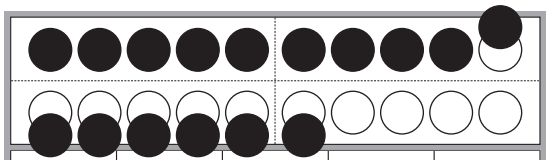

	–		=	

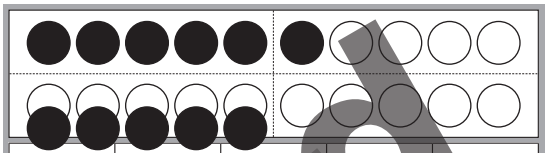

	–		=	

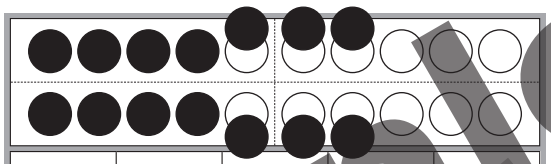

	–		=	

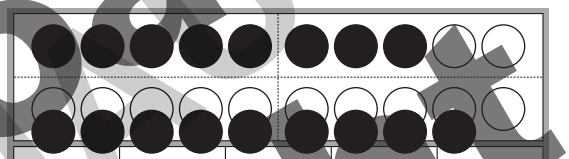

	–		=	

② Rechne!

11	–	7	=	

14	–	8	=	

16	–	9	=	

15	–	9	=	

13	–	8	=	

16	–	7	=	

12	–	7	=	

18	–	9	=	

17	–	8	=	

15	–	7	=	

③ Erfinde selbst Minusaufgaben über den Zehner!

	–		=	

	–		=	

	–		=	

	–		=	

	–		=	

	–		=	

	–		=	

	–		=	

	–		=	

Download zur Ansicht VORSCHAU

netzwerk lernen
zur Vollversion

© Persen Verlag GmbH, Buxtehude

Wir rechnen über den Zehner

① Wie heißt die Rechnung zu der Rechengeschichte?



			=	

② Rechne! Was fällt dir auf?

14	–	5	=		15	–	5	=		20	–	5	=	
13	–	5	=		15	–	6	=		19	–	4	=	
12	–	5	=		15	–	7	=		18	–	3	=	
11	–	5	=		15	–	8	=		17	–	2	=	
10	–	5	=		15	–	9	=		16	–	1	=	

③ Wie geht die Aufgabenreihe weiter! Rechne!

11	–	4	=		14	–	9	=	
12	–	4	=		15	–	8	=	
13	–	4	=		14	–	7	=	
	–		=			–		=	
	–		=			–		=	

Download zur Ansicht VORSCHAU
netzwerk lernen
zur Vollversion

© Persen Verlag GmbH, Buxtehude

Am Zahlenstrahl über den Zehner

① Wie heißt die Aufgabe?
Schreibe und rechne!

12	–	7	=	

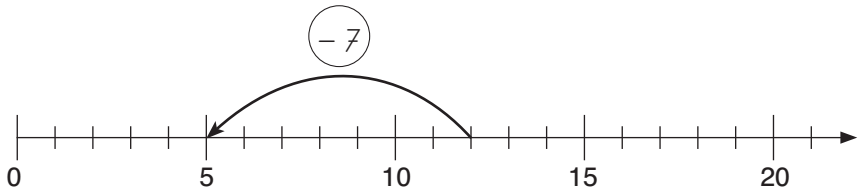

	–		=	



	+		=	

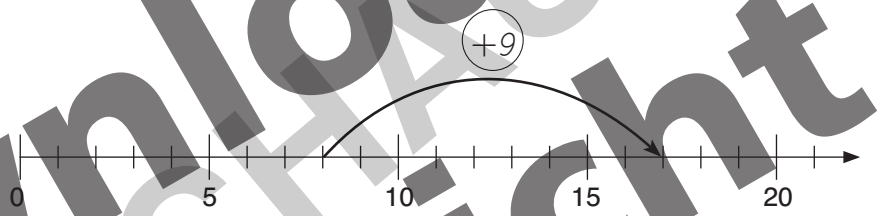

② Zeichne am Zahlenstrahl!
Rechne!

13	–	5	=	

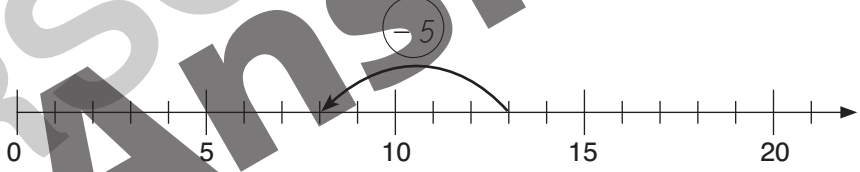

16	–	9	=	

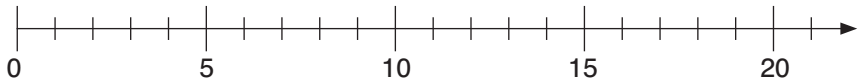

8	+	3	=	

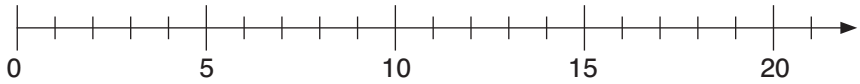

5	+	8	=	

Download VORSCHAU zur Ansicht
netzwerk lernen
zur Vollversion

© Persen Verlag GmbH, Buxtehude

Am Zahlenstrahl über den Zehner

① Wie heißt die Aufgabe?
Schreibe und rechne!

13	−	8	=	

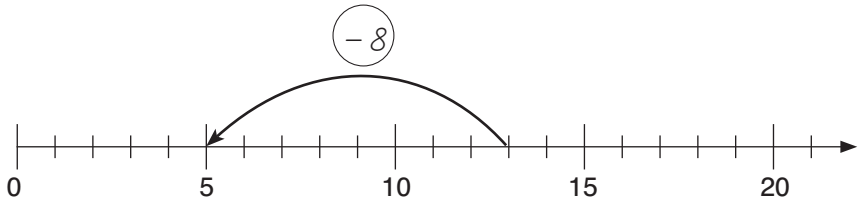

	−		=	

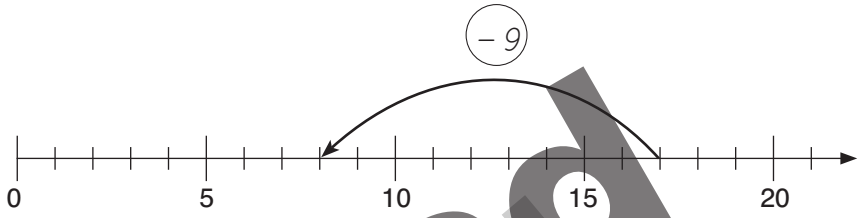

	+		=	

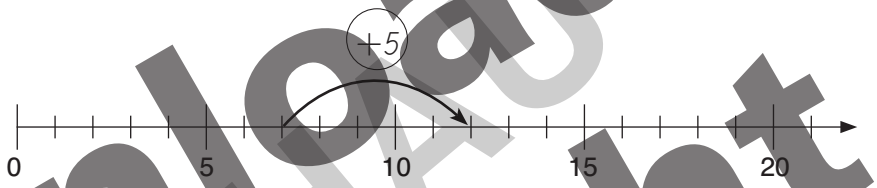

② Zeichne am Zahlenstrahl!
Rechne!

4	+	8	=	

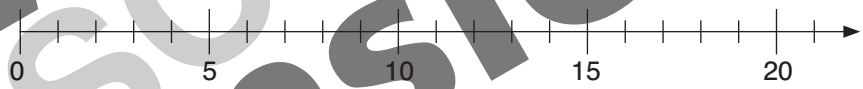

6	+	5	=	

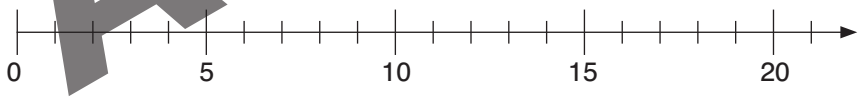

12	−	6	=	

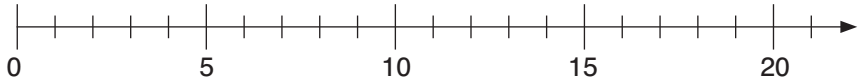

③ Erfinde selbst Aufgaben am Zahlenstrahl!

			=	

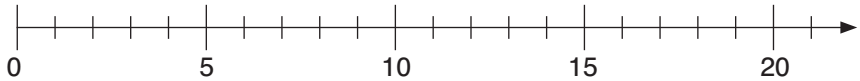

			=	

Download VORSCHAU zur Ansicht
netzwerk lernen
zur Vollversion

© Persen Verlag GmbH, Buxtehude

Name: Datum:

Plus- und Minusaufgaben bis 20

① Wie heißt die Plus- oder Minusaufgabe? Schreibe und rechne!



② Rechne die Plus- und Minusaufgaben aus!

8	+	6	=		13	−	7	=		13	+	6	=	
7	+	7	=		12	−	4	=		11	−	5	=	
9	+	5	=		18	−	9	=		8	+	3	=	
6	+	9	=		19	−	8	=		5	+	8	=	
4	+	8	=		15	−	6	=		20	−	4	=	

③ Wie geht die Aufgabenreihe weiter? Schreibe und rechne!

7	+	2	=		15	−	5	=		7	+	3	=	
7	+	3	=		14	−	5	=		8	+	3	=	
7	+	4	=		13	−	5	=		9	+	3	=	
	+		=			−		=			+		=	
			=					=					=	

④ Entscheide, ob es eine Aufgabe über den Zehner ist! Kreuze an!

5	+	8	○	18	−	5	○	11	+	4	○	15	−	7	○
7	+	9	○	15	−	3	○	9	+	4	○	16	−	6	○

Download zur Ansicht
netzwerk lernen
zur Vollversion

© Persen Verlag GmbH, Buxtehude

Name: Datum:

Plus- und Minusaufgaben bis 20

① Wie heißt die Plus- oder Minusaufgabe? Schreibe und rechne!

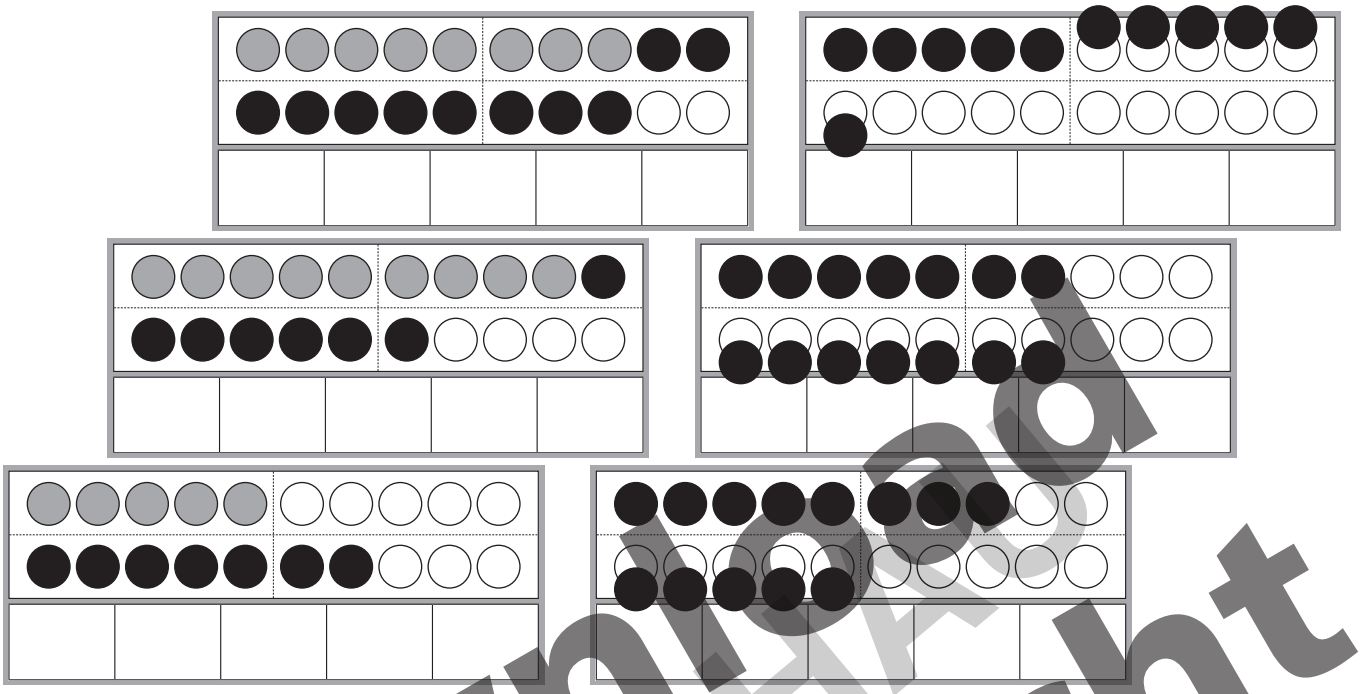

② Wie viel Geld erhältst du zurück? Kreise die Münzen ein!

③ Wie geht die Aufgabenreihe weiter? Schreibe und rechne!

9	+	6	=		13	−	7	=		13	+	6	=	
7	−	7	=		12	+	4	=		11	−	5	=	
9	+	7	=		18	−	9	=		8	+	5	=	
5	+	9	=		17	−	8	=		5	+	9	=	

④ Erfinde eigene Plus- und Minusaufgaben über den Zehner!

	+		=			−		=					=	
	+		=			−		=					=	
	+		=			−		=					=	

Download zur Ansicht
VORSCHAU
netzwerk lernen
zur Vollversion

© Persen Verlag GmbH, Buxtehude

Name: Datum:

① Wie heißt die Verdoppelungsaufgabe? Schreibe und rechne!

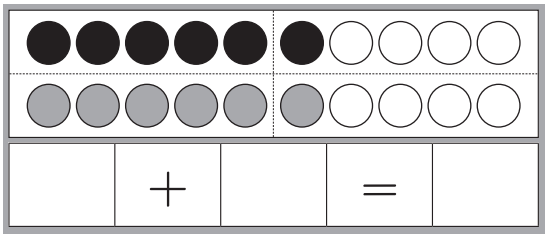

	+		=	

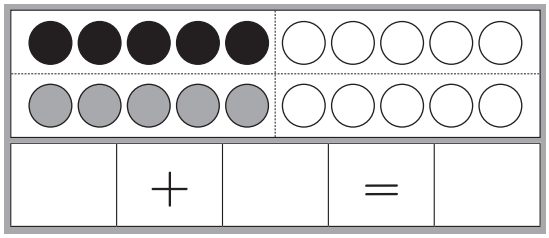

	+		=	

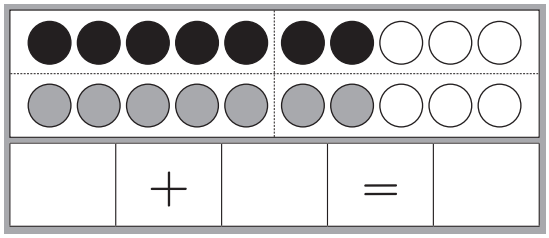

	+		=	

② Verdoppele und rechne!



4	+		=	

	+		=	

	+		=	

	+		=	

③ Verdoppele!

Zahl	2	6	8	5	10	7	9	3	0	7
das Doppelte										

④ Halbiere und rechne!



6	=		+	



	=		+	



	=		+	



	=		+	

⑤ Welche Zahl lässt sich halbieren?

Zahl	6	3	5	4	7	8	9	4	6	2
die Hälfte	2	/								

© Persen Verlag GmbH, Buxtehude

Download zur Ansicht VORSCHAU
netzwerk lernen
zur Vollversion

Name: Datum:

⑦ Finde die große Aufgabe und rechne sie aus!

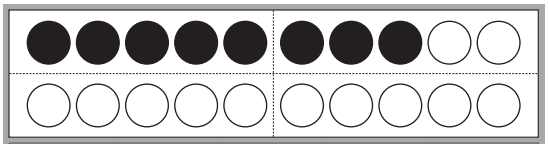

5	+	3	=	
4	+	5	=	
6	+	4	=	
1	+	8	=	
4	+	2	=	

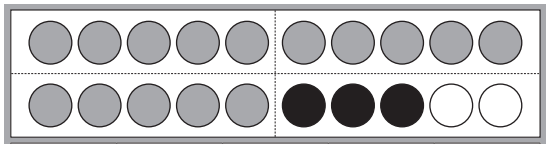

15	+	3	=	
	+		=	
	+		=	
	+		=	
	+		=	

⑧ Welche Aufgaben fehlen? Schreibe auf und rechne!

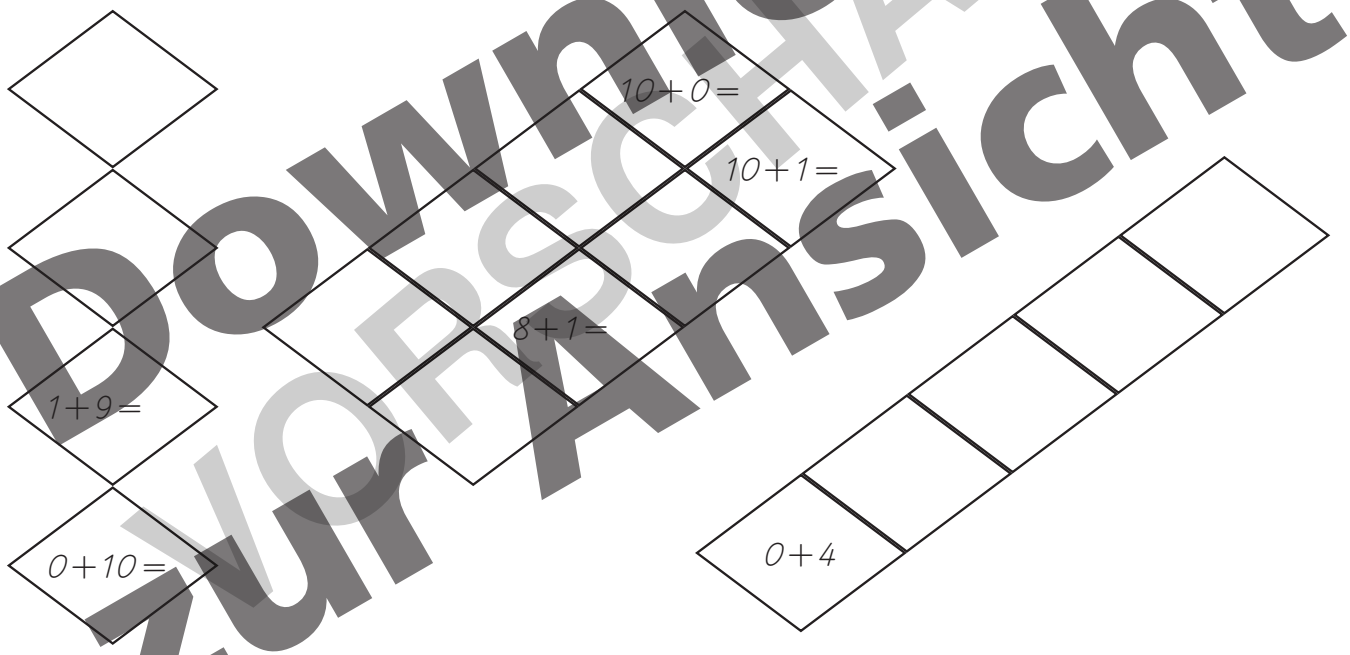

⑨ Wie geht die Reihe weiter? Rechne!

7	+	0	=		10	+	5	=		2	+	9	=	
7	+	1	=		9	+	5	=		2	+	8	=	
	+		=			+		=			+		=	
	+		=			+		=			+		=	
	+		=			+		=			+		=	

Download zur Ansicht
VORSCHAU
netzwerk lernen
zur Vollversion

© Persen Verlag GmbH, Buxtehude

Gemischte Aufgaben

① Löse die Rechendreiecke!

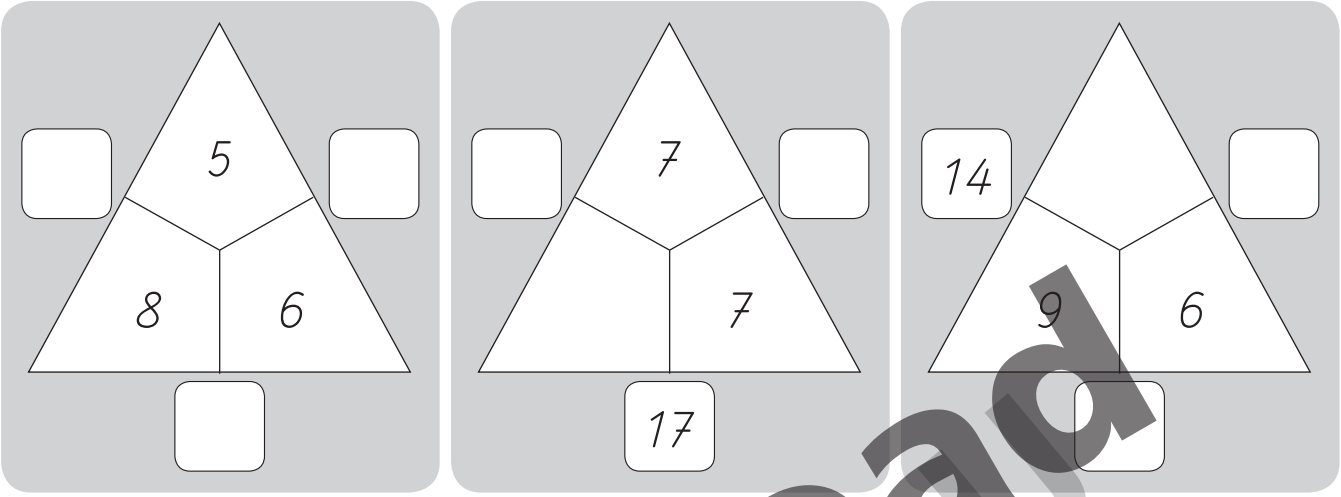

② Löse die Rechengeschichten!

Wir wissen: Susi geht auf dem Markt einkaufen. Im Obstkorb des Händlers liegen 13 Birnen. Susi kauft 7 Birnen.

Wir wissen: Peter bringt seine Ersparnisse zur Sparkasse. In seinem Sparschwein hat er 7 € gespart. In seiner Geldbörse sind noch 4 € und seine Mutter gibt ihm 4 €.

Download zur Ansicht
VORSCHAU
netzwerk lernen
zur Vollversion

© Persen Verlag GmbH, Buxtehude